Klockan: hela och halva timmar

Matteblad med jultema · Åk 2

Vad är klockan? Skriv tiden under varje klocka

Åk 2 · hela och halva timmar

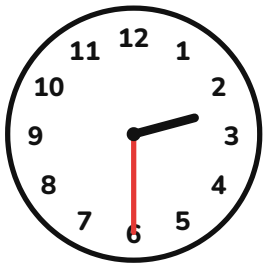


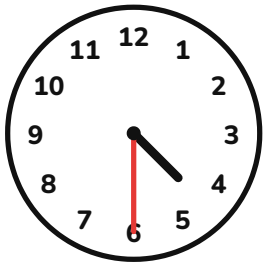

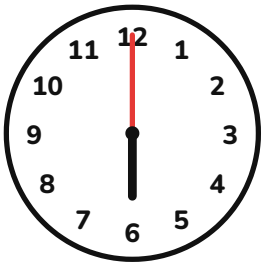



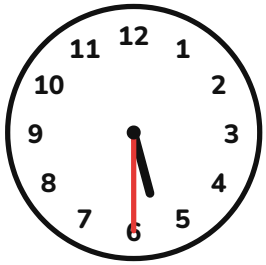



Namn: _____

Facit: Klockan: hela och halva timmar

Facit för vuxna

Facit

1. 2:30 (halv 3)
2. 9:00 (klockan 9)
3. 9:30 (halv 10)
4. 4:30 (halv 5)
5. 6:30 (halv 7)
6. 6:00 (klockan 6)
7. 3:00 (klockan 3)
8. 11:30 (halv 12)
9. 2:00 (klockan 2)
10. 5:30 (halv 6)
11. 3:30 (halv 4)
12. 1:30 (halv 2)

För vuxna: rätta tillsammans och låt barnet räkna om det som blev fel.