# Horas no relógio: exatas e meias

Atividade de matemática de Natal · 2º ano

## Que horas são? Escreva a hora embaixo de cada relógio

2º ano · horas exatas e meias horas

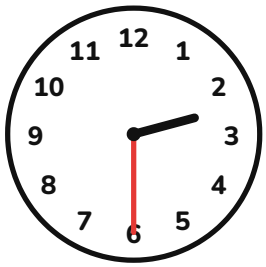


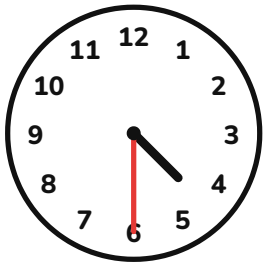

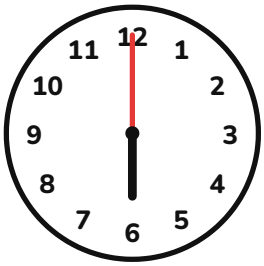



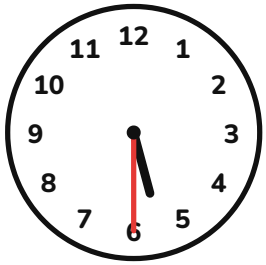



**Nome:** _____

# Respostas: Horas no relógio: exatas e meias

Gabarito para os adultos

## Respostas

1. 2:30 (2 e meia)
2. 9:00 (9 em ponto)
3. 9:30 (9 e meia)
4. 4:30 (4 e meia)
5. 6:30 (6 e meia)
6. 6:00 (6 em ponto)
7. 3:00 (3 em ponto)
8. 11:30 (11 e meia)
9. 2:00 (2 em ponto)
10. 5:30 (5 e meia)
11. 3:30 (3 e meia)
12. 1:30 (1 e meia)

Para os adultos: corrijam juntos e refaçam as contas que ficaram erradas.