Horas no relógio: exatas e meias

Atividade de matemática de Natal · 2º ano

Que horas são? Escreva a hora embaixo de cada relógio

2º ano · horas exatas e meias horas

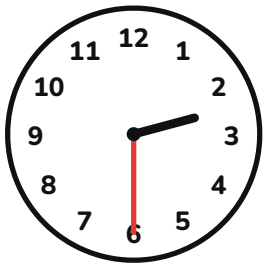




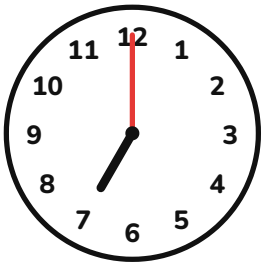
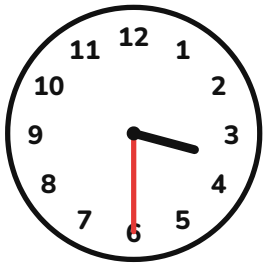
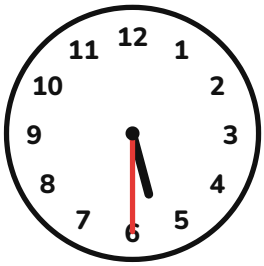





Nome: _____

Respostas: Horas no relógio: exatas e meias

Gabarito para os adultos

Respostas

1. 2:30 (2 e meia)
2. 10:30 (10 e meia)
3. 11:30 (11 e meia)
4. 1:30 (1 e meia)
5. 10:00 (10 em ponto)
6. 7:00 (7 em ponto)
7. 3:30 (3 e meia)
8. 5:30 (5 e meia)
9. 2:00 (2 em ponto)
10. 7:30 (7 e meia)
11. 5:00 (5 em ponto)
12. 8:00 (8 em ponto)

Para os adultos: corrijam juntos e refaçam as contas que ficaram erradas.