Klokka: hele og halve timer

Matteark · 2. trinn

Hva er klokka? Skriv tiden under hver klokke

2. trinn · hele og halve timer

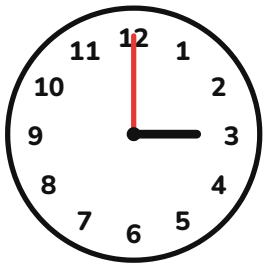
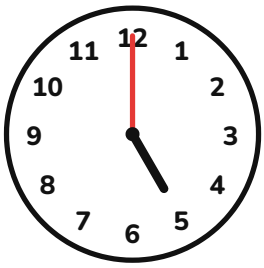


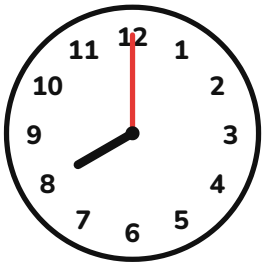
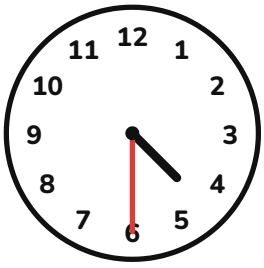
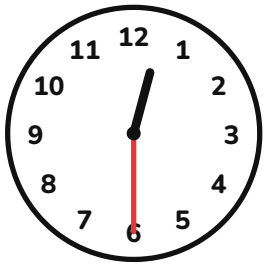
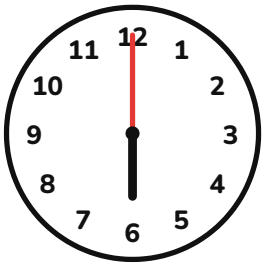
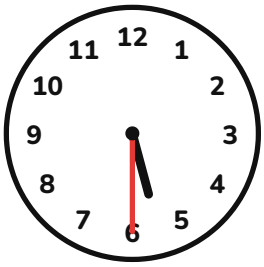
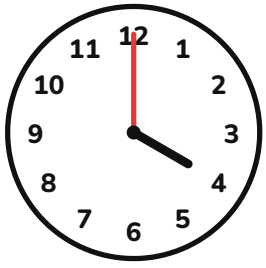
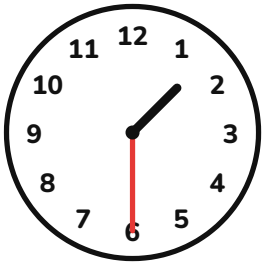

Navn: _____

Fasit: Klokka: hele og halve timer

Fasit for voksne

Fasit

1. 3:00 (klokka 3)
2. 5:00 (klokka 5)
3. 1:00 (klokka 1)
4. 7:30 (halv 8)
5. 8:00 (klokka 8)
6. 4:30 (halv 5)
7. 12:30 (halv 1)
8. 6:00 (klokka 6)
9. 5:30 (halv 6)
10. 4:00 (klokka 4)
11. 1:30 (halv 2)
12. 7:00 (klokka 7)

For voksne: rett sammen og la barnet regne feilene på nytt.