Klokka: hele og halve timer

Matteark · 2. trinn

Hva er klokka? Skriv tiden under hver klokke

2. trinn · hele og halve timer



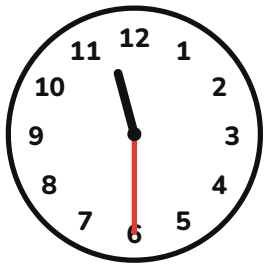
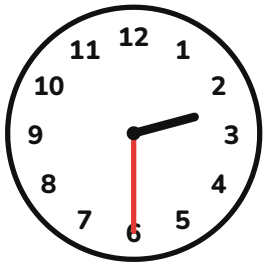
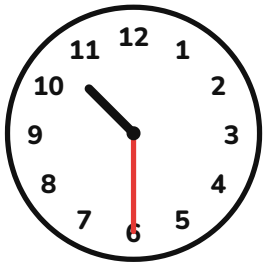
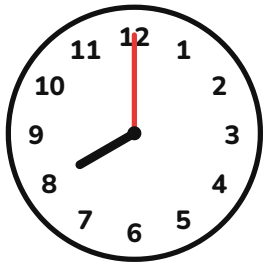
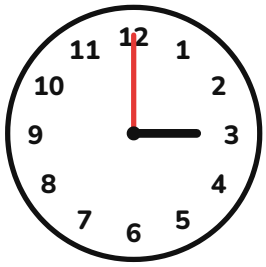
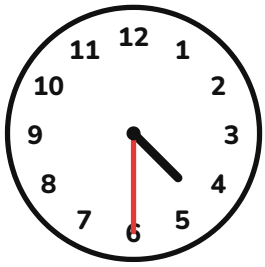
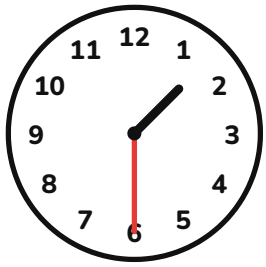
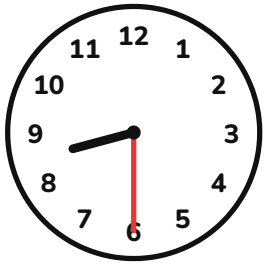

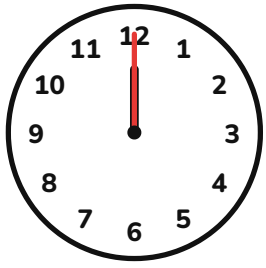

Navn: _____

Fasit: Klokka: hele og halve timer

Fasit for voksne

Fasit

1. 2:00 (klokka 2)
2. 5:00 (klokka 5)
3. 11:30 (halv 12)
4. 2:30 (halv 3)
5. 10:30 (halv 11)
6. 8:00 (klokka 8)
7. 3:00 (klokka 3)
8. 4:30 (halv 5)
9. 1:30 (halv 2)
10. 8:30 (halv 9)
11. 1:00 (klokka 1)
12. 12:00 (klokka 12)

For voksne: rett sammen og la barnet regne feilene på nytt.