Klokka: hele og halve timer

Matteark med juletema · 2. trinn

Hva er klokka? Skriv tiden under hver klokke

2. trinn · hele og halve timer

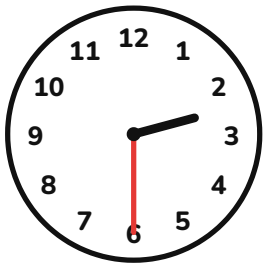


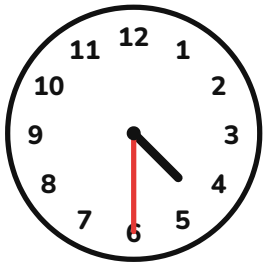

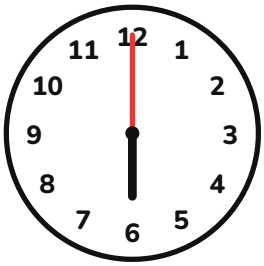



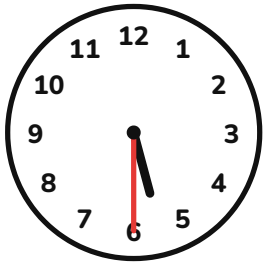



Navn: _____

Fasit: Klokka: hele og halve timer

Fasit for voksne

Fasit

1. 2:30 (halv 3)
2. 9:00 (klokka 9)
3. 9:30 (halv 10)
4. 4:30 (halv 5)
5. 6:30 (halv 7)
6. 6:00 (klokka 6)
7. 3:00 (klokka 3)
8. 11:30 (halv 12)
9. 2:00 (klokka 2)
10. 5:30 (halv 6)
11. 3:30 (halv 4)
12. 1:30 (halv 2)

For voksne: rett sammen og la barnet regne feilene på nytt.