Klokkijken: hele en halve uren

Rekenblad · Groep 4

Hoe laat is het? Schrijf de tijd onder elke klok

Groep 4 · hele en halve uren

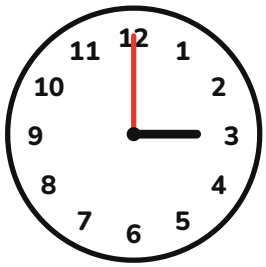
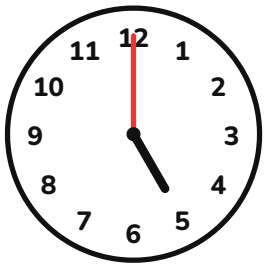


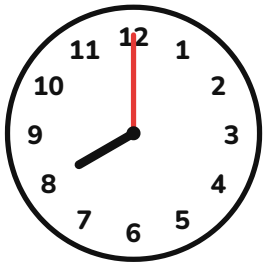
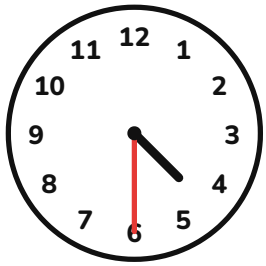

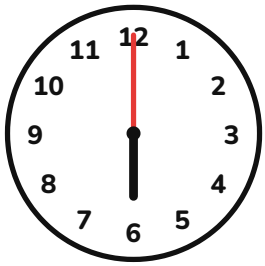
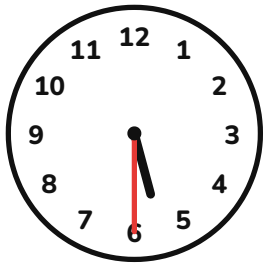


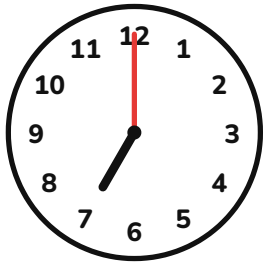

Naam: _____

Antwoorden: Klokkijken: hele en halve uren

Antwoordblad voor volwassenen

Antwoorden

1. 3:00 (3 uur)
2. 5:00 (5 uur)
3. 1:00 (1 uur)
4. 7:30 (half 8)
5. 8:00 (8 uur)
6. 4:30 (half 5)
7. 12:30 (half 1)
8. 6:00 (6 uur)
9. 5:30 (half 6)
10. 4:00 (4 uur)
11. 1:30 (half 2)
12. 7:00 (7 uur)

Voor volwassenen: kijk samen na en reken een fout gewoon nog een keer uit.