Klokkijken: hele en halve uren

Rekenblad · Groep 4

Hoe laat is het? Schrijf de tijd onder elke klok

Groep 4 · hele en halve uren




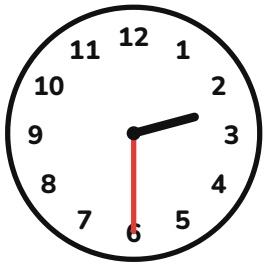





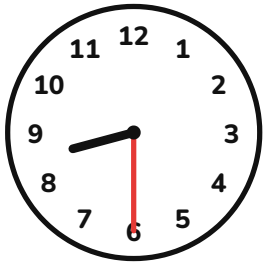

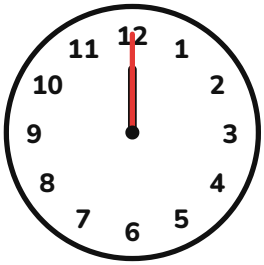

Naam: _____

Antwoorden: Klokkijken: hele en halve uren

Antwoordblad voor volwassenen

Antwoorden

1. 2:00 (2 uur)
2. 5:00 (5 uur)
3. 11:30 (half 12)
4. 2:30 (half 3)
5. 10:30 (half 11)
6. 8:00 (8 uur)
7. 3:00 (3 uur)
8. 4:30 (half 5)
9. 1:30 (half 2)
10. 8:30 (half 9)
11. 1:00 (1 uur)
12. 12:00 (12 uur)

Voor volwassenen: kijk samen na en reken een fout gewoon nog een keer uit.