Compléments à 10

CP · cycle 2

Combien de ronds manque-t-il pour faire 10 ? Complète.

Les compléments à 10

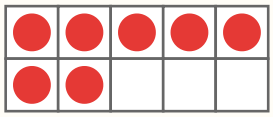

7 + ____ = 10

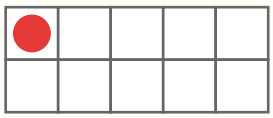

1 + ____ = 10

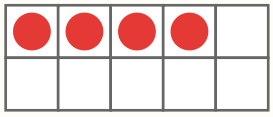

4 + ____ = 10



8 + ____ = 10

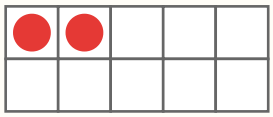

2 + ____ = 10

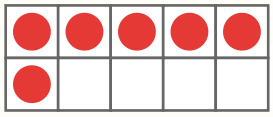

6 + ____ = 10

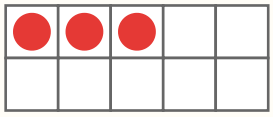

3 + ____ = 10



9 + ____ = 10

Prénom : _____

Corrigé : Compléments à 10

Les réponses de la fiche, CP

Corrigé

7 + 3 = 10

4 + 6 = 10

2 + 8 = 10

3 + 7 = 10

1 + 9 = 10

8 + 2 = 10

6 + 4 = 10

9 + 1 = 10

Page pour l'adulte. Vous pouvez la garder pour corriger ensemble.