# Telling Time Worksheet

Math worksheet · 1st grade

**What time is it? Write the time under each clock**

1st grade · time to the hour and half hour

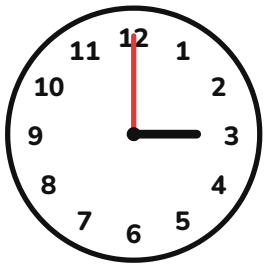
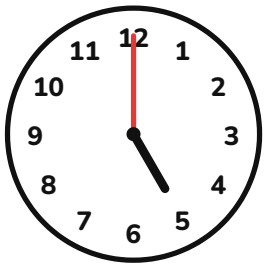




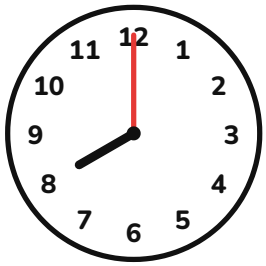
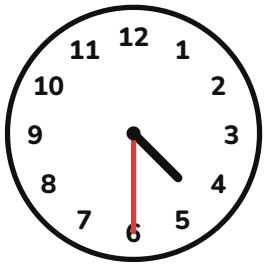

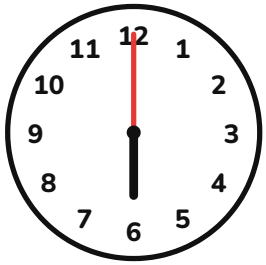
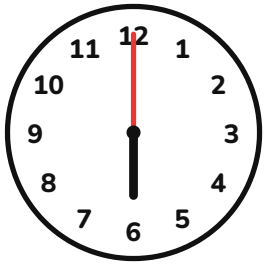
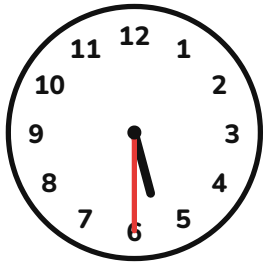

**Name:** _____

# Answers: Telling Time Worksheet

Answer key for grown-ups

## Answer key

| | | |
|---|---|---|
| 1. 3:00 | 2. 5:00 | 3. 1:00 |
| 4. 3:00 | 5. 1:00 | 6. 7:30 |
| 7. 8:00 | 8. 4:30 | 9. 12:30 |
| 10. 6:00 | 11. 6:00 | 12. 5:30 |

For grown-ups: check together, and treat a mistake as a reason to count again.