Counting Coins

Math worksheet · 2nd grade

Count the coins and write the total in cents

2nd grade · penny 1¢, nickel 5¢, dime 10¢, quarter 25¢

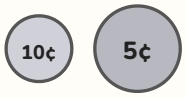

= ____ ¢

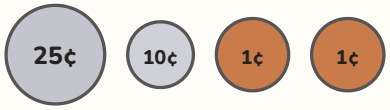

= ____ ¢



= ____ ¢

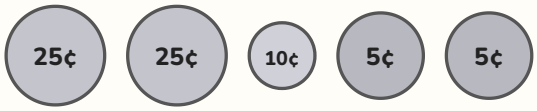

= ____ ¢

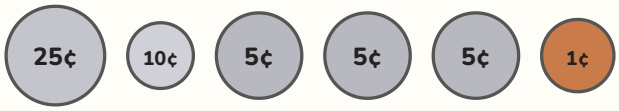

= ____ ¢

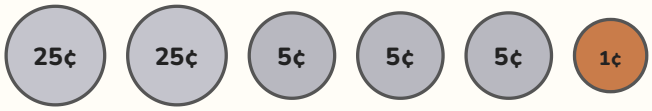

= ____ ¢



= ____ ¢

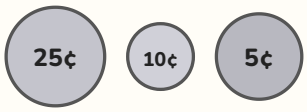

= ____ ¢

Name: _____

Answers: Counting Coins

Answer key for grown-ups

Answer key

1. 15¢	**2. 37¢**	**3. 35¢**	**4. 70¢**
5. 51¢	**6. 66¢**	**7. 6¢**	**8. 40¢**

For grown-ups: check together, and treat a mistake as a reason to count again.