Christmas Telling Time Worksheet

Christmas math worksheet · 1st grade

What time is it? Write the time under each clock

1st grade · time to the hour and half hour

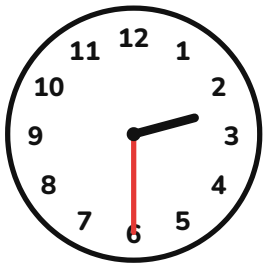


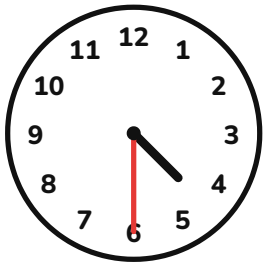

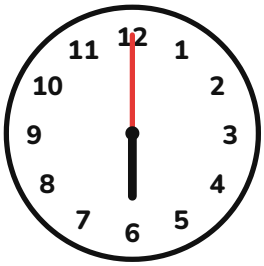


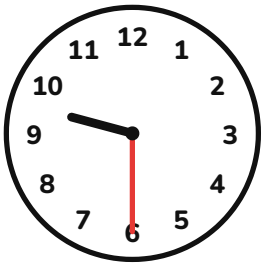
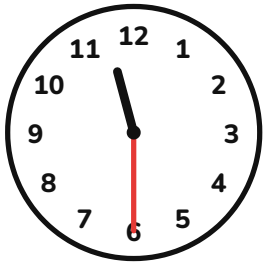
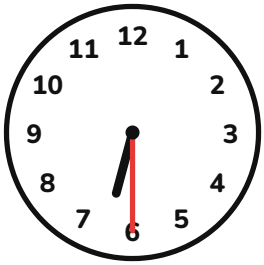

Name: _____

Answers: Christmas Telling Time Worksheet

Answer key for grown-ups

Answer key

1. 2:30	2. 9:00	3. 9:30
4. 4:30	5. 6:30	6. 6:00
7. 3:00	8. 2:30	9. 9:30
10. 11:30	11. 6:30	12. 2:00

For grown-ups: check together, and treat a mistake as a reason to count again.