Christmas Telling Time Worksheet

Christmas math worksheet · 1st grade

What time is it? Write the time under each clock

1st grade · time to the hour and half hour

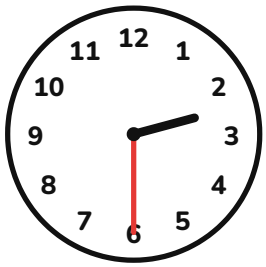

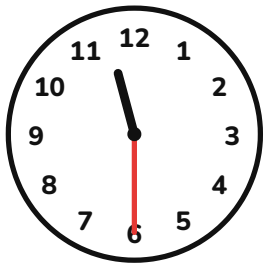


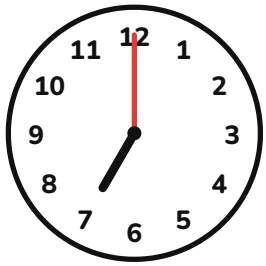
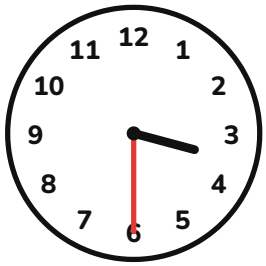
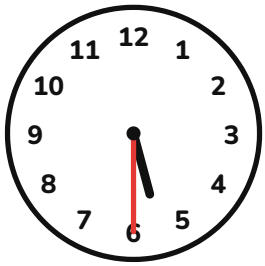


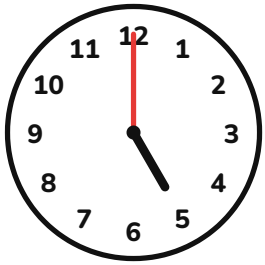
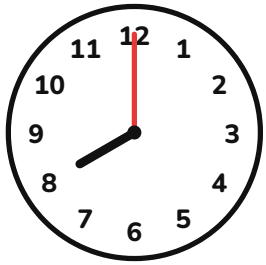

Name: _____

Answers: Christmas Telling Time Worksheet

Answer key for grown-ups

Answer key

1. 2:30	2. 10:30	3. 11:30
4. 1:30	5. 10:00	6. 7:00
7. 3:30	8. 5:30	9. 2:00
10. 7:30	11. 5:00	12. 8:00

For grown-ups: check together, and treat a mistake as a reason to count again.