Uhrzeit lernen

Mathe-Arbeitsblatt · Klasse 2

Wie spät ist es? Schreib die Uhrzeit unter jede Uhr

Klasse 2 · volle und halbe Stunden

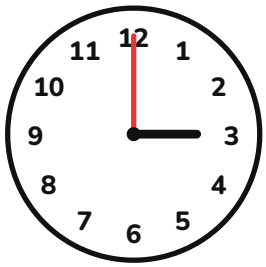











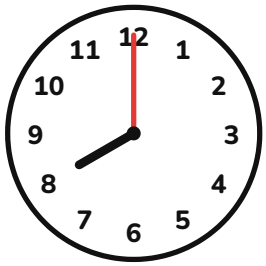





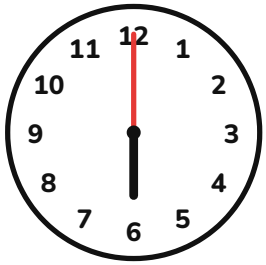

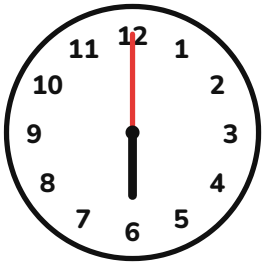

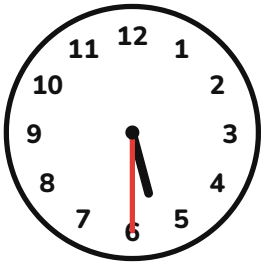

Name: _____

Lösungen: Uhrzeit lernen

Lösungsblatt für Erwachsene

Lösungen

1. 3:00 Uhr
2. 5:00 Uhr
3. 1:00 Uhr
4. 3:00 Uhr
5. 1:00 Uhr
6. 7:30 Uhr
7. 8:00 Uhr
8. 4:30 Uhr
9. 12:30 Uhr
10. 6:00 Uhr
11. 6:00 Uhr
12. 5:30 Uhr

Für Erwachsene: gemeinsam kontrollieren und einen Fehler als Anlass nehmen, noch einmal zu rechnen.