Uhrzeit lernen: Weihnachten

Weihnachtliches Mathe-Arbeitsblatt · Klasse 2

Wie spät ist es? Schreib die Uhrzeit unter jede Uhr

Klasse 2 · volle und halbe Stunden

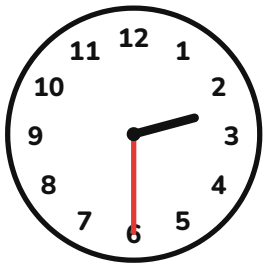

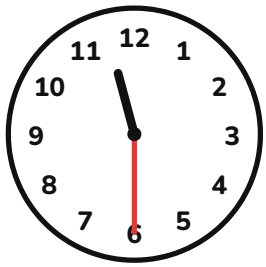


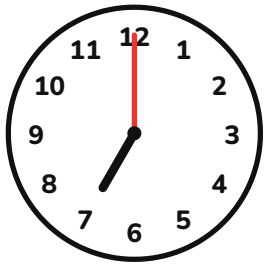
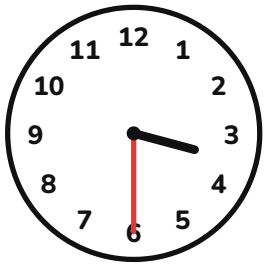
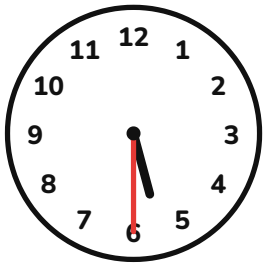


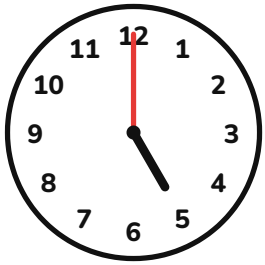
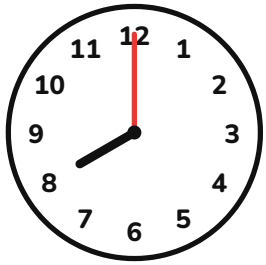

Name: _____

Lösungen: Uhrzeit lernen: Weihnachten

Lösungsblatt für Erwachsene

Lösungen

1. 2:30 Uhr
2. 10:30 Uhr
3. 11:30 Uhr
4. 1:30 Uhr
5. 10:00 Uhr
6. 7:00 Uhr
7. 3:30 Uhr
8. 5:30 Uhr
9. 2:00 Uhr
10. 7:30 Uhr
11. 5:00 Uhr
12. 8:00 Uhr

Für Erwachsene: gemeinsam kontrollieren und einen Fehler als Anlass nehmen, noch einmal zu rechnen.