Klokken: hele og halve timer

Matematikopgaver · 2. klasse

Hvad er klokken? Skriv tiden under hvert ur

2. klasse · hele og halve timer

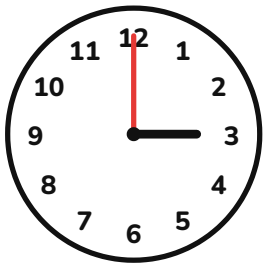
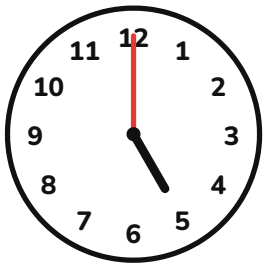


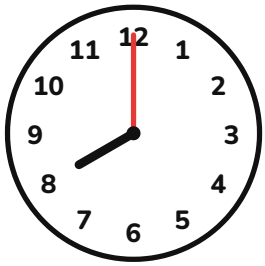
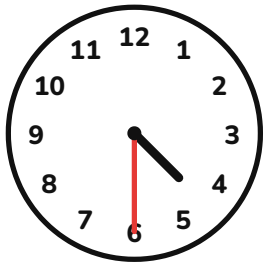

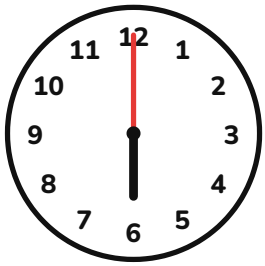
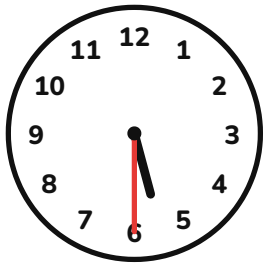


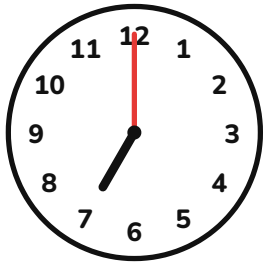

Navn: _____

Facitliste: Klokken: hele og halve timer

Facit til voksne

Facitliste

1. 3:00 (klokken 3)
2. 5:00 (klokken 5)
3. 1:00 (klokken 1)
4. 7:30 (halv 8)
5. 8:00 (klokken 8)
6. 4:30 (halv 5)
7. 12:30 (halv 1)
8. 6:00 (klokken 6)
9. 5:30 (halv 6)
10. 4:00 (klokken 4)
11. 1:30 (halv 2)
12. 7:00 (klokken 7)

Til voksne: ret opgaverne sammen, og lad barnet regne fejlene igen.