Klokken: hele og halve timer

Matematikopgaver · 2. klasse

Hvad er klokken? Skriv tiden under hvert ur

2. klasse · hele og halve timer


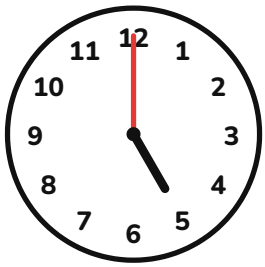
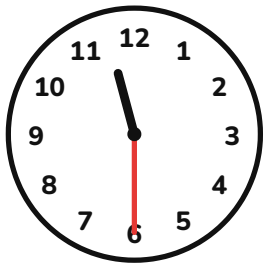
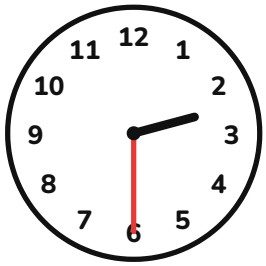

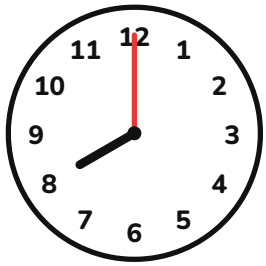

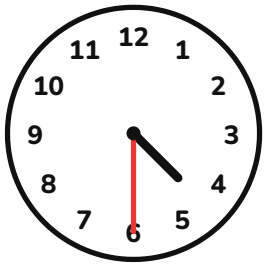

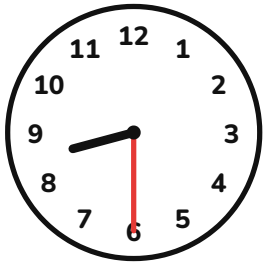

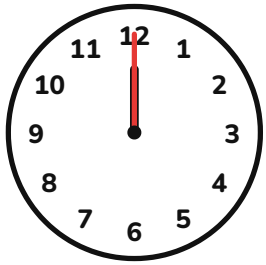

Navn: _____

Facitliste: Klokken: hele og halve timer

Facit til voksne

Facitliste

1. 2:00 (klokken 2)
2. 5:00 (klokken 5)
3. 11:30 (halv 12)
4. 2:30 (halv 3)
5. 10:30 (halv 11)
6. 8:00 (klokken 8)
7. 3:00 (klokken 3)
8. 4:30 (halv 5)
9. 1:30 (halv 2)
10. 8:30 (halv 9)
11. 1:00 (klokken 1)
12. 12:00 (klokken 12)

Til voksne: ret opgaverne sammen, og lad barnet regne fejlene igen.