Klokken: hele og halve timer

Matematikopgaver med juletema · 2. klasse

Hvad er klokken? Skriv tiden under hvert ur

2. klasse · hele og halve timer

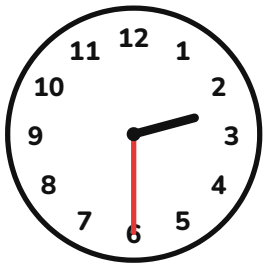


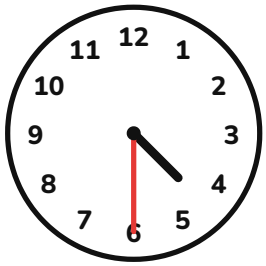

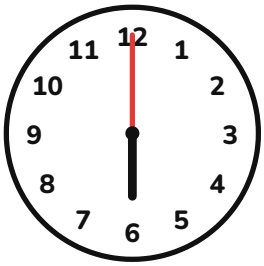



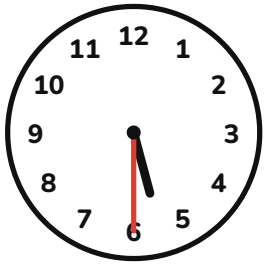



Navn: _____

Facitliste: Klokken: hele og halve timer

Facit til voksne

Facitliste

1. 2:30 (halv 3)
2. 9:00 (klokken 9)
3. 9:30 (halv 10)
4. 4:30 (halv 5)
5. 6:30 (halv 7)
6. 6:00 (klokken 6)
7. 3:00 (klokken 3)
8. 11:30 (halv 12)
9. 2:00 (klokken 2)
10. 5:30 (halv 6)
11. 3:30 (halv 4)
12. 1:30 (halv 2)

Til voksne: ret opgaverne sammen, og lad barnet regne fejlene igen.