Klokken: hele og halve timer

Matematikopgaver med juletema · 2. klasse

Hvad er klokken? Skriv tiden under hvert ur

2. klasse · hele og halve timer

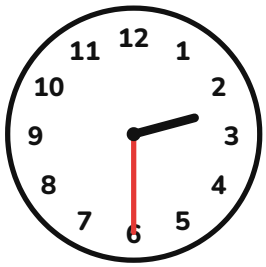

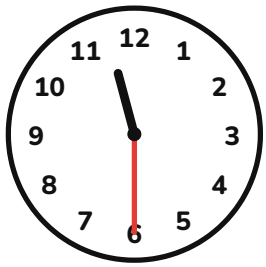


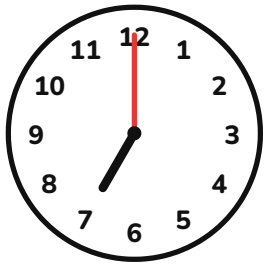
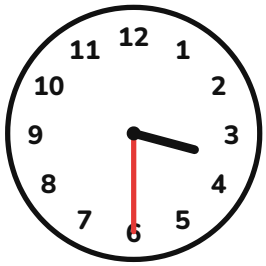
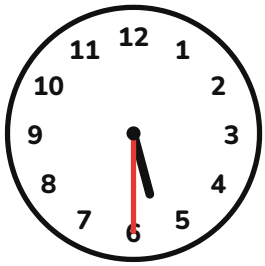


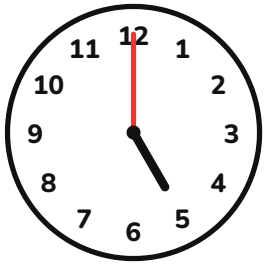
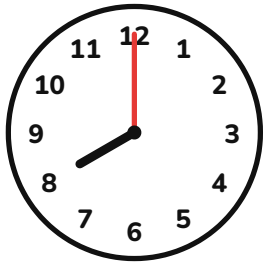

Navn: _____

Facitliste: Klokken: hele og halve timer

Facit til voksne

Facitliste

1. 2:30 (halv 3)
2. 10:30 (halv 11)
3. 11:30 (halv 12)
4. 1:30 (halv 2)
5. 10:00 (klokken 10)
6. 7:00 (klokken 7)
7. 3:30 (halv 4)
8. 5:30 (halv 6)
9. 2:00 (klokken 2)
10. 7:30 (halv 8)
11. 5:00 (klokken 5)
12. 8:00 (klokken 8)

Til voksne: ret opgaverne sammen, og lad barnet regne fejlene igen.